Name: Study Sheet Section:

Chord Writing!

Write a I, IV and V Chord based on the given Key (Do):

1. Figure out the root (bottom note) for each chord (1, 4, and 5).
2. Form a triad by adding two notes above each root. (Snowman)
3. Check the quality of each chord (Major or Minor) by checking the space between the notes. Add sharps or flats *if needed!*

In the key of C



In the key of D



In the key of G



REMINDER: Each staff should contain 3 chords. This page should have a total of 9 chords for your answer to be complete.

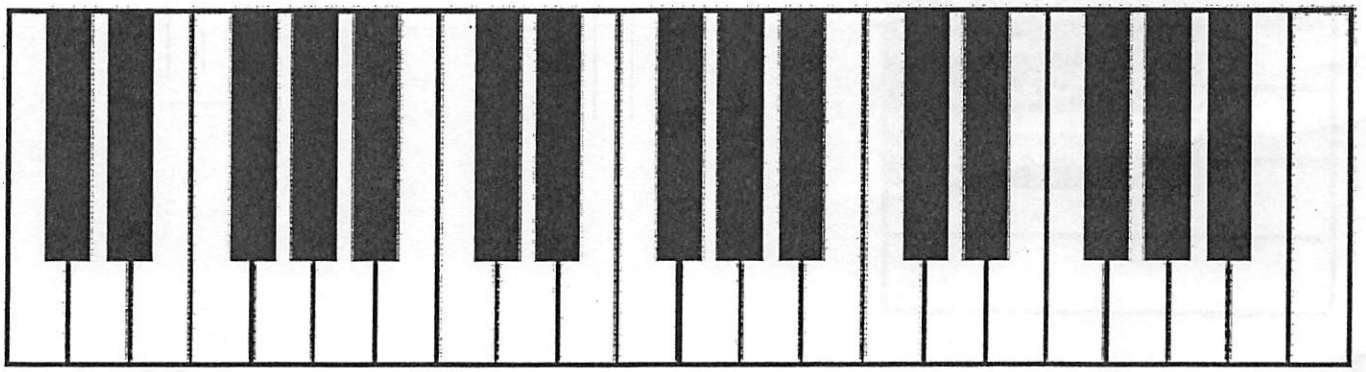

Form a Major Triad based on the note (root) you have been given:


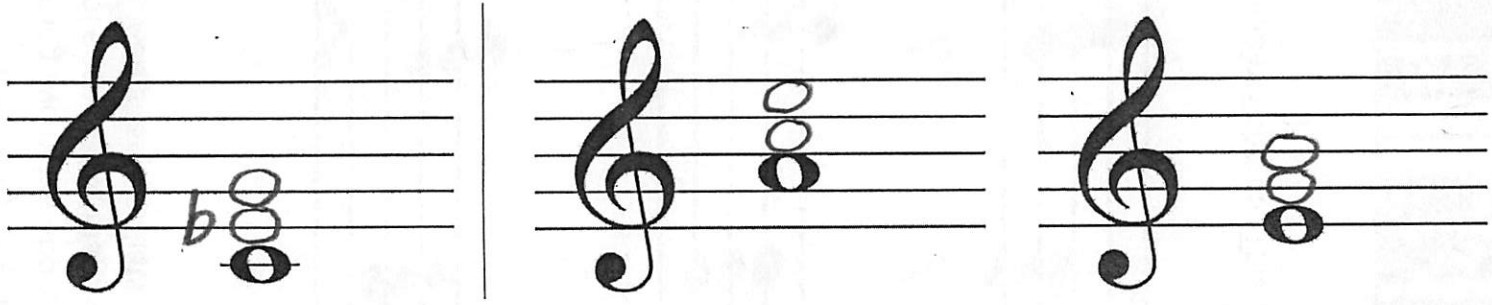
Form a Minor Triad based on the note (root) you have been given: